# Transport Subtraction

Each of the vehicles below are on a journey. Each have completed part of the journey, but still have a long way to travel. Use column subtraction to calculate how much further each one has to travel to arrive at their destination.



**Aeroplane**
**Journey:** 3470 miles
**Completed so far:** 2140 miles

**Remaining distance:** _____

| | | | | |
|---|---|---|---|---|
| | 3 | 4 | 7 | 0 |
| - | 2 | 1 | 4 | 0 |
| | | | | |



**Bus**
**Journey:** 7845 miles
**Completed so far:** 3623 miles

**Remaining distance:** _____

| | | | | |
|---|---|---|---|---|
| | 7 | 8 | 4 | 5 |
| - | 3 | 6 | 2 | 3 |
| | | | | |



**Truck**
**Journey:** 7403 miles
**Completed so far:** 4189 miles

**Remaining distance:** _____

| | | | | |
|---|---|---|---|---|
| | 7 | 4 | 0 | 3 |
| - | 4 | 1 | 8 | 9 |
| | | | | |



**Car**
**Journey:** 6074 miles
**Completed so far:** 4638 miles

**Remaining distance:** _____

| | | | | |
|---|---|---|---|---|
| | 6 | 0 | 7 | 4 |
| - | 4 | 6 | 3 | 8 |
| | | | | |



visit twinkl.com

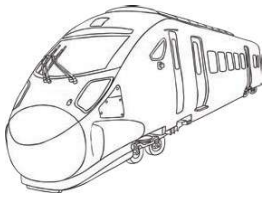

**Train**
**Journey:** 4061 miles
**Completed so far:** 3623 miles

$$\begin{array}{r} 4061 \\ -\ 3623 \\ \hline \\ \hline \end{array}$$

**Remaining distance:** _____



**Helicopter**
**Journey:** 8053 km
**Completed so far:** 6645 km

$$\begin{array}{r} 8053 \\ -\ 6645 \\ \hline \\ \hline \end{array}$$

**Remaining distance:** _____

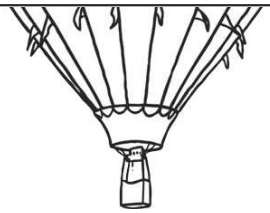

**Hot Air Balloon**
**Journey:** 6502 km
**Completed so far:** 3679 km

$$\begin{array}{r} 6502 \\ -\ 3679 \\ \hline \\ \hline \end{array}$$

**Remaining distance:** _____



**Ship**
**Journey:** 5082 km
**Completed so far:** 2674 km

$$\begin{array}{r} 5082 \\ -\ 2674 \\ \hline \\ \hline \end{array}$$

**Remaining distance:** _____



**Submarine**
**Journey:** 8604 miles
**Completed so far:** 4793 miles

$$\begin{array}{r} 8604 \\ -\ 4793 \\ \hline \\ \hline \end{array}$$

**Remaining distance:** _____



visit twinkl.com

# Super Sale

At the department store, there was a special one-day sale on all items. Below you will find the shopping for one customer with the original price and the sale price of each item they bought. Calculate the money saved on each item by using **column subtraction.** Use the space below the table to complete your calculations, and then write your answers on the table.

| Item | Original Price | Sale Price | Money Saved |
|---|---|---|---|
| A television | £1467 | £623 | |
| A kettle | £24.36 | £8.24 | |
| A mirror | £89.43 | £11.51 | |
| A new coat | £54.72 | £22.16 | |
| Shoes | £72.38 | £24.25 | |
| A jumper | £36.00 | £12.48 | |
| A dress | £43.56 | £12.82 | |
| A new coat | £58.25 | £32.43 | |

Show your working out here:

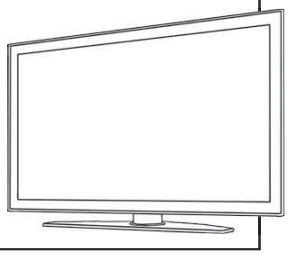



visit twinkl.com